15.2 Area of Parallelograms and Trapezoids

Math 7

15.2 Corrective Assignment #1

Instructions: Find the area of each figure.

1.

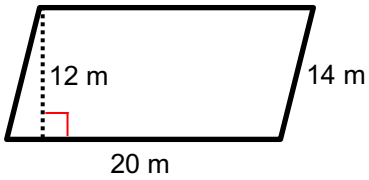

Area:_____

2.

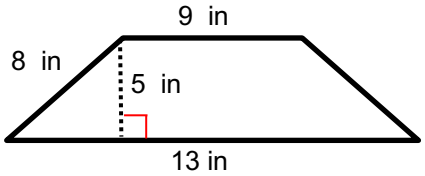

Area:_____

3.

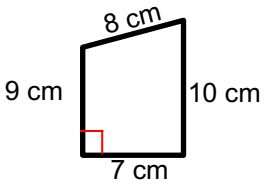

Area:_____

4.

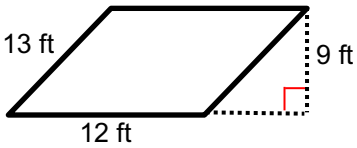

Area:_____

5.

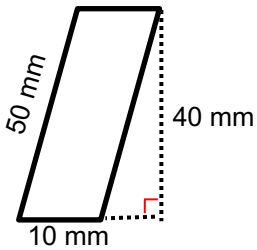

Area:_____

6.

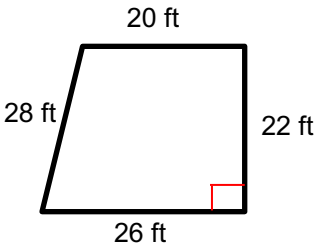

Area:_____

Answers 15.2 CA #1:

1. A = bh A = (20)(12) A = 240 m^2	2. A = ½(b₁ + b₂)h A = ½(7 + 13)5 A = 55 in^2	3. A = ½(b₁ + b₂)h A = ½(9 + 10)7 A = 66.5 cm^2
4. A = bh A = (12)(9) A = 108 ft^2	5. A = bh A = (10)(40) A = 400 mm^2	6. A = ½(b₁ + b₂)h A = ½(20 + 28)22 A = 506 ft^2

© The Algebros from FlippedMath.com